INDIAN INSTITUTE OF CRAFTS & DESIGN

Entrance Test – Written

for Under Graduate (UG) Programme

Paper – I
General Awareness, Creativity & Perception Test

Total Time : 2 Hours

Total Marks : 100

Date :

Time :

Candidate Enrollment No	Invigilator's Signature with date

SAMPLE

INSTRUCTIONS FOR THE CANDIDATE

1. This paper is divided into two sections: Section A & Section B
2. Paper contains total 31 Questions
3. Each Question has been allotted marks on the right side of the question
4. Read all the questions carefully
5. Do not write your name anywhere in the test paper
6. Follow the instructions given by the invigilators
7. On completion of the test, you should hand over the test paper to the invigilator before leaving the hall
8. Make sure you have written your Candidate Enrollment Number correctly and clearly.

INDIAN INSTITUTE OF CRAFTS & DESIGN

SECTION – A

General Awareness Test

(Question no. 1 - 25)

Note: Each question carry 1 Mark

---

1. Match the following traditional sarees to their native states:

a. Pochampally	1. West Bengal
b. Baluchari	2. Rajasthan
c Paithani	3. Andhra Pradesh
d. Leharia	4. Maharashtra

Answer:

A. A2, B1, C3, D4 B. A3, B2, C4, D1

C. A3, B1, C4, D2 D. A4, B2, C1, D3

2. _____ is an Indian who has won Nobel Peace Prize for 2014..

3. Complete the series:

a. 2, 4, 8, 32, 256, _____ , _____

b. 7, 10 , 8, 11, 9, 12, _____ , _____

4. Count the total number of triangles:



SAMPLE

5. Rabindranath Tagore's 'Jana Gana Mana' has been adopted as India's National Anthem. How many stanzas of the said song were adopted?

A. Only the first stanza
B. The whole song
C. Third and Fourth stanza
D. First and Second stanza

6. 'Kantha' is a folk form of textile. Where does it come from?

A. Odisha
B. Bihar
C Bengal
D. Andhra Pradesh

7. PDM is the acronym for:

A. Project drawing management
B. Product drawing manipulation
C. Product data management
D. Project data manipulation

8. How many surfaces of a cube can be seen at a time?

A. 6
B. 3
C. 4
D. 2

9. Which is the correct order of the colours of the rainbow-

A. VIBGORIY
B. VIBGYOR
C. YIRQBGV
D. GYORVIB

10. The quality of colour is---

A. Hue
B. Value
C. Chroma or intensity
D. All of these

11. Harmony Means----

A. Variation of texture
B. Absence of unnecessary elements
C. Variation of colours
D. None of these

12. The image is deleted through----

A. Hand Tool
B. Zoom Tool
C. Type Tool
D. Eraser Tool

SAMPLE

13. Which of the following belongs to hardware----

A. Printer
B. Adobe PageMaker
C. Corel Draw
D. Adobe Photoshop

14. The city of Cannes in France is best known for a.

A. Film Festival
B. Fashion Week
C. Tennis Championship
D. Formula One Racing

15. Virgin Atlantic is the name of

A. A drink
B. An island in the Atlantic Ocean
C. An airline
D. A deodorant

16. 1 inch is equal to

A. 2.54 cm
B. 5 cm
C. 20 mm
D. 15.67 m

17. The words 'Satyameva Jayate' inscribed below the base plate of the emblem of India are taken from

A. Rigveda
B. Satpath Brahmana
C. Mundak Upanishad
D. Ramayana

18. Who composed the famous song 'Sare Jahan Se Achha'?

A. Jaidev
B. Mohd. Iqbal
C. Mahatma Gandhi
D. Naushad

19. The name of Pierre Cardin is associated with which of the following fields?

A. Films
B. Pop Music
C. Painting
D. Fashion Designing

20. Which is a UNESCO Heritage Site

A. Rani Ki Vaav
B. Nahargarh Fort
C. Kerala Backwaters
D. None of the these

SAMPLE

21. Which among the following is connected to Indian National Movement?

A. Silk B. Jute

C. Khadi D. Nylon

22. Anish Kapur is a

A. Painter B. Sculptor

C. Musician D. Writer

23. Which of the following is a solid geometrical form?

A. Circle B. Triangle

C. Rectangular D. Cube

24. 'Chandrayaan -1' is related to.

A. Crafts B. Literature

C. Sports D. Space Technology

25. Brass Is a mixture of

A. Copper and Steel B. Copper and Zinc

C. Zinc and Tin D. Steel with high lead content

25. 'Rhythm' means---

A. Movement B. Space

C. Form D. Emphasis

SAMPLE

INDIAN INSTITUTE OF CRAFTS & DESIGN

SECTION – B

Creativity and Perception Test

(Question no. 26 to 31)

Note : Each Question has been allotted marks on the right side of the question

Objectives of the Test:

1. To assess your abilities such as estimate of sizes & proportion
2. To assess skills of observation and synthesis
3. To assess abilities of visual interpretation

---

26. How many triangles appear in the below figure? (5 Marks)

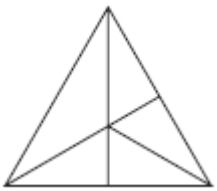

A. 5 B. 6 C. 10 D. 12

Answer: _____

27. Divide the rectangle into two segments of equal size and area, so that each segment contains the same number of triangles, bells and circles. (5 Marks)

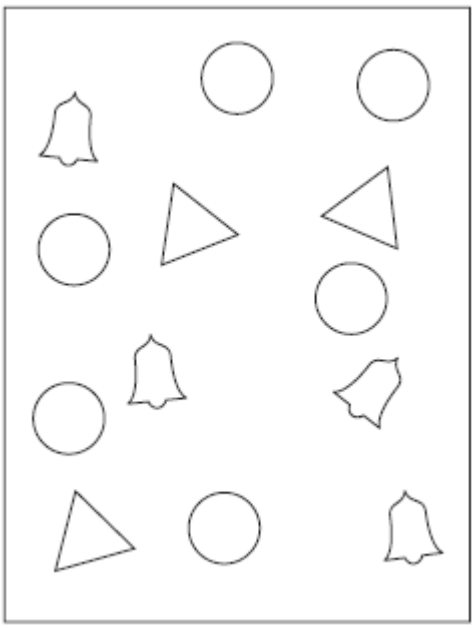

Answer: _____

SAMPLE

28. When the figure Z is folded to form a cube, which is the only one of the following that can be produced? (5 Marks)

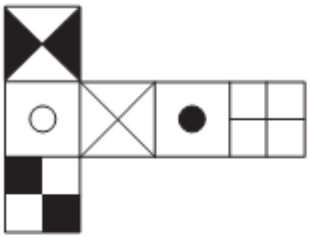

Figure Z

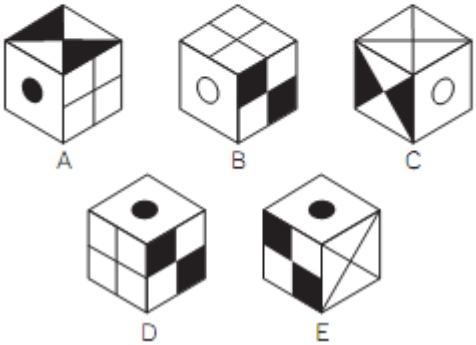

Answer:

29. If X is superimposed on Y, Which of the OUTLINES below will result? (5 Marks)



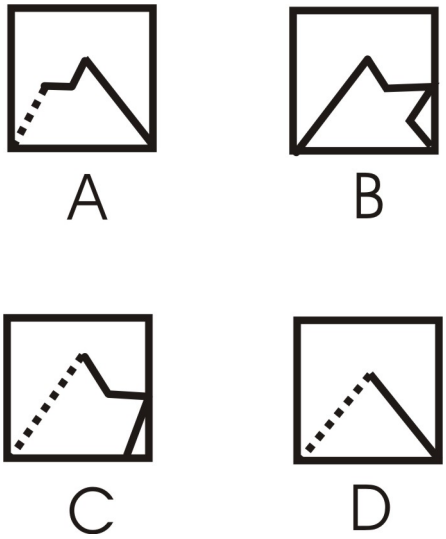

Answer: _____

SAMPLE

30. If the three iron bars are all the same length, which one will support the greatest weight? (5 Marks)

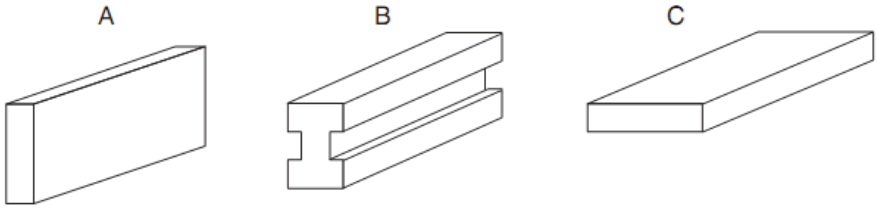

a) A b) B c) C d) all the same

Answer: _____

31. Imagine yourself as an Ant in a spoonful of sugar.

31 A. Draw the details of the above-mentioned situation in 4 steps. (25 Marks)

SAMPLE

31 B. Describe your feeling as an ant in the above-mentioned situation in 150 words.

(25 Marks)

Answer:

SAMPLE

INDIAN INSTITUTE OF CRAFTS & DESIGN

EXTRA SHEET

SAMPLE

INDIAN INSTITUTE OF CRAFTS & DESIGN

EXTRA SHEET

SAMPLE

INDIAN INSTITUTE OF CRAFTS & DESIGN

EXTRA SHEET

SAMPLE